Niveau : sixieme

La médiatrice

Exercice 1 : jusitifier si un point est sur la médiatrice

Sur chaque figure, indique si le point P appartient à la médiatrice de [AB]. Justifie.

a.

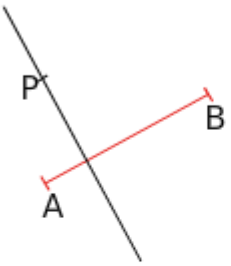

b.

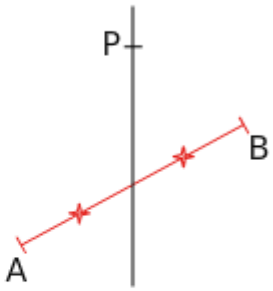

c.

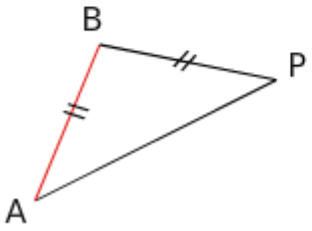

d.

