Niveau : sixieme

Polygones et constructions

Exercice 23 : nature et constructions de quadrilatères

Les quadrilatères sont tracés à main levée.

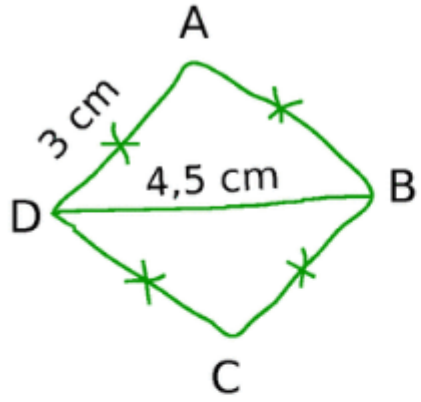

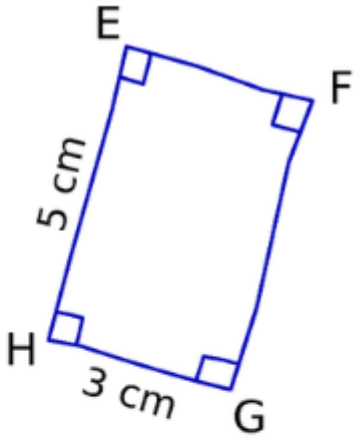

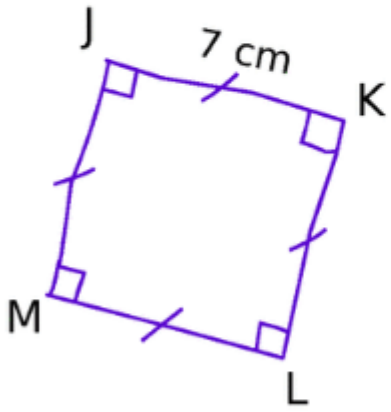

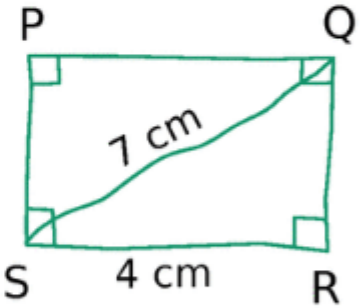

a. Donne la nature de chaque quadrilatère. Justifie.

b. Construis chacun de ces quadrilatères en vraie grandeur.