Niveau : CM2

Les fractions décimales

Exercice 24 : donner l'abscisse de chaque point

Écris l'abscisse de chaque point.

a.

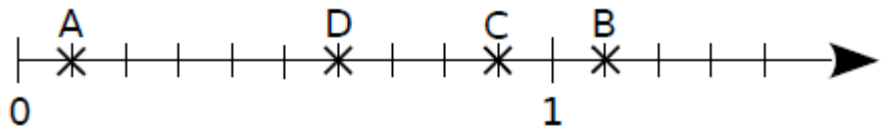

A(.....) B(.....) C(.....) D(.....)

b.

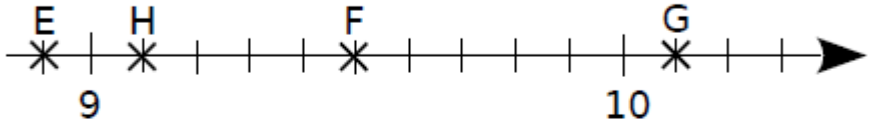

E(.....) F(.....) G(.....) H(.....)

c.

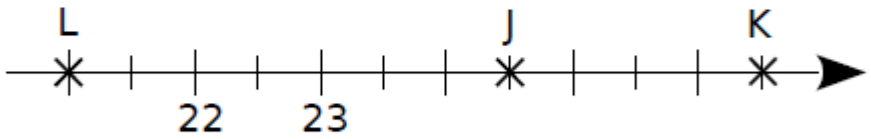

J(.....) K(.....) L(.....)

d.

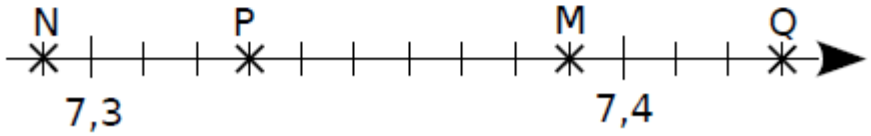

M(.....) N(.....) P(.....) Q(.....)

Document pédagogique téléchargé sur maths-pdf.fr