Niveau : CM2

Les fractions décimales

Exercice 25 : placer des points sur l'axe gradué

Place les points sur les demi-droites graduées.

a. A(0,7) ; B(1,2) et C(2,1).

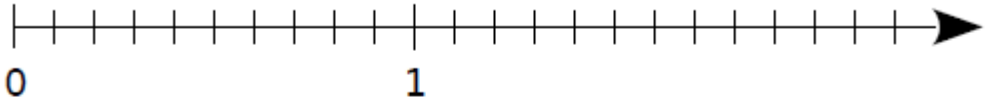

b. D(9,3) ; E(10,1) et F(8,8).

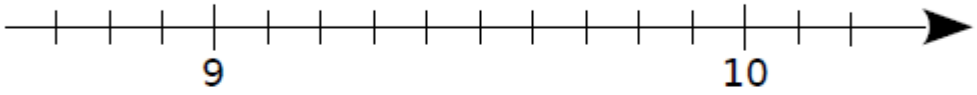

c. G(3,85) ; H(3,77) et J(3,91).

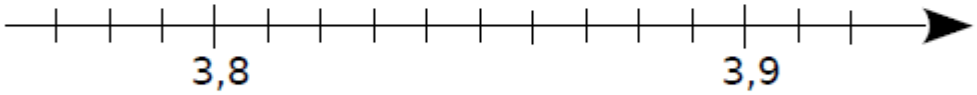

d. K(9,97) ; L(9,89) et M(10,02).

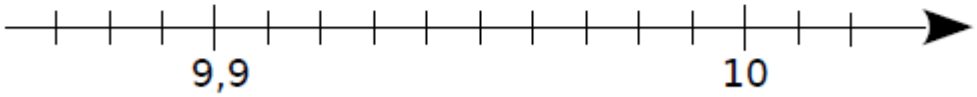

e. N(0,001) ; P(0,013) et Q(0,009).

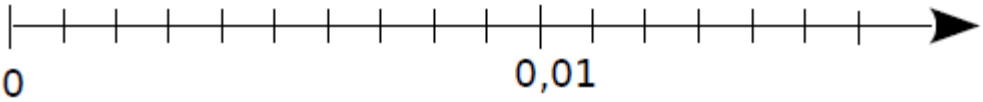

Document pédagogique téléchargé sur maths-pdf.fr