Niveau : CM2

Solides de l'espace

Exercice 2 : compléter les perspectives cavalières

Complète les représentations en perspective de chaque solide en traçant les pointillés.

a.

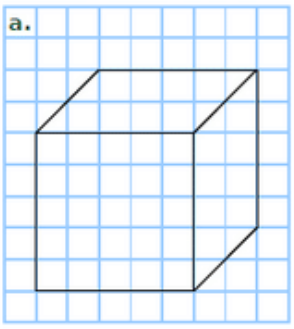

b.

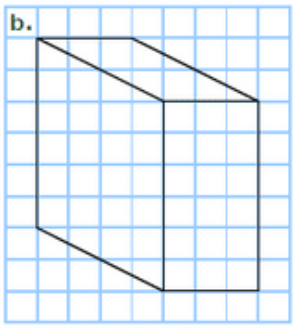

c.

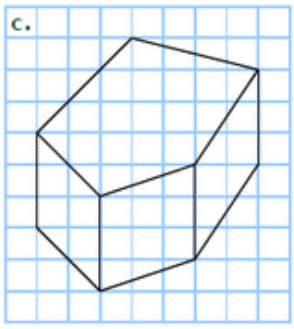

d.

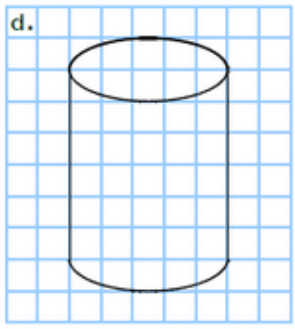

Document pédagogique téléchargé sur maths-pdf.fr