Niveau : sixieme

La médiatrice

Exercice 5 : médiatrice d'un segment et justification

Dans quels cas la droite (d) est-elle la médiatrice de [AB]? Justifier la réponse.

a) 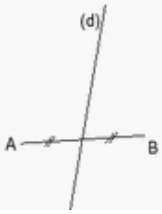

b) 

c) 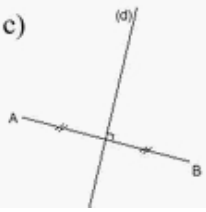

d) 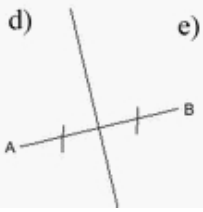

e) 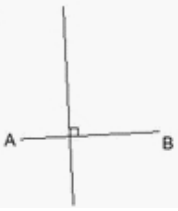

Document pédagogique téléchargé sur maths-pdf.fr